Plocha mnohouholníkov/polygónov

1. Vypočítaj plochu nasledujúcich mnohouholníkov. Pomôže ti ich rozdelenie na celé a polovičné štvorčeky.

A

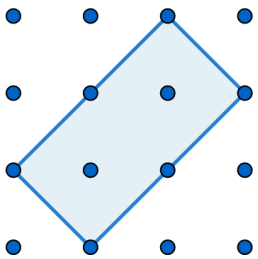

Plocha = …… cm²

B

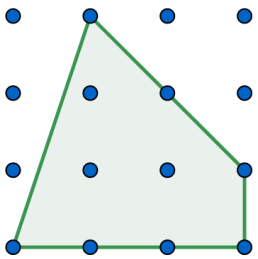

Plocha = …… cm²

C

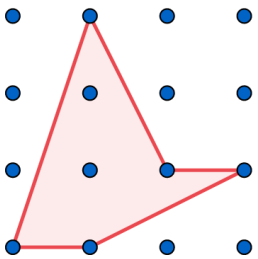

Plocha = …… cm²

D

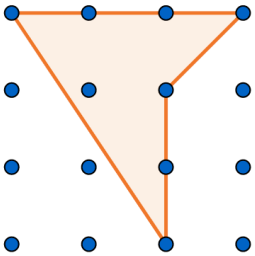

Plocha = …… cm²

E

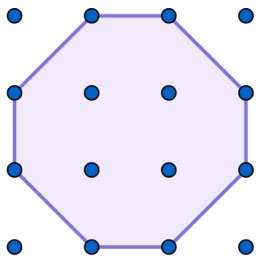

Plocha = …… cm²

F

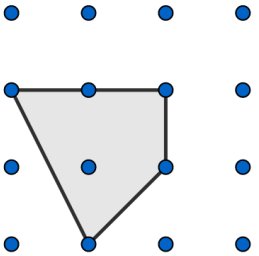

Plocha = …… cm²

G

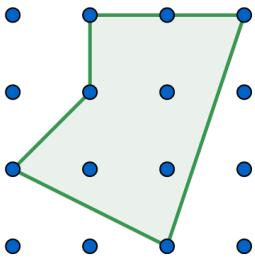

Plocha = …… cm²

H

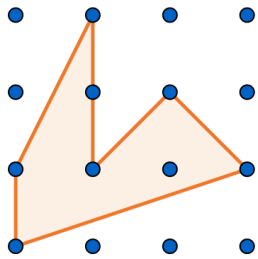

Plocha = …… cm²

I

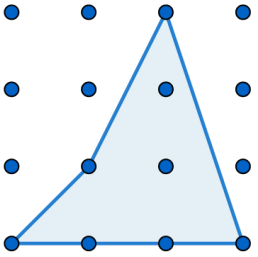

Plocha = …… cm²

2. **Zotrieď jednotlivé polygóny podľa ich plochy od najväčšej po najmenšiu.**

---

3. **Navrhni 3 svoje mnohouholníky na mriežkach 4 × 4 a vyskúmaj ich plochy.**



Plocha = …… cm²



Plocha = …… cm²



Plocha = …… cm²